MONDAY

1. 28 × 5 = _____ × 10
2. 95 + 35 = _____
3. What is the new price after a 20% discount? $1.00

   _____
4. 6304 – 8 = _____
5. Round 8.49 to the nearest whole. _____
6. 80 × 8 = _____
7. 79 × 8 = _____
8. 9 + 3 ÷ 1 = _____
9. A = acute O = obtuse R = reflex

   _____ _____ _____
10. Without looking, what is the probability of randomly picking an ace from a pack of 52 playing cards?

    ☐ $\frac{1}{4}$ ☐ $\frac{4}{4}$ ☐ $\frac{4}{52}$ ☐ $\frac{13}{52}$
11. 4 × 100 = 50 × _____
12. 10 ÷ 2 = 4 + _____
13. Draw the 5 lines of symmetry.
14. 4090 + _____ = 10 000
15. $\frac{1}{2} + \frac{1}{4} = \frac{\square}{4}$
16. $\frac{1}{3}$ of 120 is _____.
17. Draw an arrow to show 4800 rpm.
18. What is the value of 6 in 164 900?

    _____
19. The perimeter is 26 cm.

    Side a = _____ m

    Not to scale, a, 10 m
20. Area = _____

MY SCORE

TUESDAY

1. What is the missing integer?

   –6 –4 –2 ☐ 2
3. (a) 40 × 7 = _____ (b) 39 × 7= _____.
4. 7 + 3 × 2 = _____
2. Area = _____

   3 m, 4 m, Not to scale
5. Which array shows a prime number?

   ☐ ☐
6. 3000, 2985, 2955, 2910, _____
7. 7090 – 100 = _____
8. The perimeter = _____ mm

   400 mm, 20 cm
9. 6303 ☐ 100 = 63.03
10. 1 ha = _____ m^2
11. The value is _____.

    0.1 0.01 0.001
12. –8 < –1 ☐ true ☐ false
13. 2 L 58 mL = _____ mL
14. In 932 200, the value of 9 is _____.
15. The mixed number at:

    A is _____

    B is _____

    2, $2\frac{1}{2}$, 3, $3\frac{1}{2}$, 4; A, B
16. 1001, 991, 982, 974, 976, _____, 956
17. 24 × 32 = odd or even? _____
18. 25 × 24 × 4 = _____
19. $\frac{3}{4} + \frac{1}{2} = \frac{\square}{4}$ or _____ $\frac{\square}{4}$
20. $\frac{12}{16} = \frac{12 \div \square}{16 \div \square} = \frac{3}{4}$

MY SCORE

Week 14

WEDNESDAY

1. What is the product of 4 and 8? _____

2. (a) 50 × 8 = _____ (b) 49 × 8 = _____

3. 2307 – 9 = _____

4. Round 8.99 to the nearest whole. _____

5. Complete the multiples of 12.

12	24	36	48
60		84	

6. 36 ÷ _____ = 10

7. 8001 – 7 = _____

8. The value is _____.

9. 17 × 13 = ☐ odd ☐ even

10. 24 × 25 = 6 × _____

11. Colour 2 parallel sides.

12. What is the sum of all angles in a hexagon?

_____

13. 64 × 6 = (_____ × _____) + (_____ × _____)

= 360 + _____

= _____

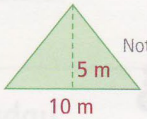

14. Area = _____ cm²

15. 80% = $\frac{\square}{20}$ = 0._____

16. 9994 + 7 = _____

17. 10.15 pm 15 April → 3.30 pm 16 April

What is the time difference? _____

18. What is the probability of randomly picking a king or queen from a pack of 52 playing cards?

Write as a fraction. _____

19. What is one third of 900 000? _____

20. The mixed number at:

(a) A is _____

(b) B is _____

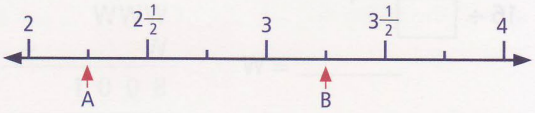

MY SCORE

THURSDAY

1. 390 + 90 = _____

2. 203 = 7 × _____ *(Think! 210 = 30 × 7)*

3. How many triangles can you find?

_____

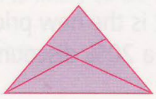

4. A number pattern starts at 5 and increases by 4s. What position in the sequence is 41?

☐ 7th ☐ 8th ☐ 9th ☐ 10th

5. –3 > 2 ☐ true ☐ false

6. **Maths test scores**

Looking at the dot plot graph, how many scored more than 86?

_____

7. – $15.50 = _____

8. $6\frac{1}{3} - 1\frac{1}{3}$ = _____

9. Write $\frac{35}{8}$ as a mixed number. _____

10. 3 L 35 mL = _____ mL

11. 7 × 8 = 4 × _____ = 56

12. 0.5 × 40 = _____

13. 25 + 25 + 25 + 25 = _____

14. $\frac{9}{100}$ = _____ % = 0._____

15. 3 × 100 = 50 × _____

16. The area of a square with 5-cm sides is _____.

17. $\frac{4}{6} - \frac{1}{3} = \frac{\square}{6} = \frac{\square}{3}$

18. 27 ÷ _____ = 2.7

19. The surfboard was $350, now it costs _____.

20. 210 – 90 = _____

MY SCORE

PROBLEM-SOLVING

Monday

Outcomes of a 2-coin toss

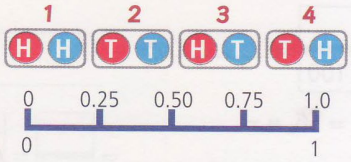

1. The probability of 2 tails is _____.
2. The probability of a head and a tail is _____.

Tuesday

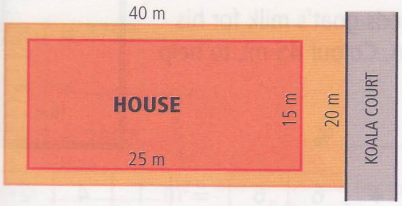

1. The building site land area is _____.
2. The house footprint has a total area of _____.

Wednesday

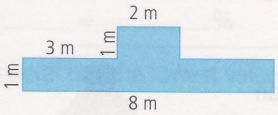

1. Area = _____
2. Perimeter = _____

Thursday

1.

GUITAR MAN

Restring guitar	$30	
New strings	$10	
+ 10% GST	A	$
TOTAL	B	$

2. A new phone was advertised at $300, excluding 10% GST. What will be the actual cost?

_____

MY SCORE

FRIDAY REVIEW

1. 30 × 7 = _____

   29 × 7 = _____

2. 80 + 90 = _____

3. What is the smallest odd number you can create using 4, 8, 4, 7 and 2?

   _____

4. 2707 ☐ 100 = 27.07

5. The mixed number at:

   a is _____

   b is _____

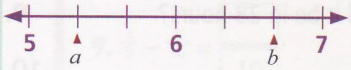

6. 9001 − 7 = _____

7. 16 × 25 = 4 × _____

8. 4 > − 5 = ☐ true ☐ false

9. 18 ÷ 3 × 3 = _____

10. The sharpener was $5, now

    _____.

11. 78 + 98 = _____

12. $\frac{1}{2} - \frac{1}{4} = \frac{\square}{4}$

13. $\frac{4}{100}$ = 0._____

    = _____%

14. 20 − 20 ÷ 4 = _____

15. 84 ÷ _____ = 0.84

16. 2 × 100 = 4 × _____

17. 100 × 0.008 = _____

18. 34 × 7 = (_____ × 7)

    + (_____ × 7)

    = 210 + _____

    = _____

19. 1003, 993, 984, 976, 969,

    _____, 958

20. What is the time difference?

    _____

    8.45 am 18 April → 10.15 am 19 April

21. a = _____

    b = _____

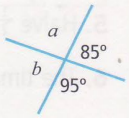

22. The area of a square with 3-cm sides is

    _____.

23. What 2D shape will you see in the cross-section?

    _____

24. Using Thursday's dot plot, how many scored an A if an A is 85% or more?

    _____

25. As a fraction, what is the probability of randomly picking a jack from a deck of 52 playing cards?

    _____

MY SCORE